Calculate the circumference and area of each circle.

1. 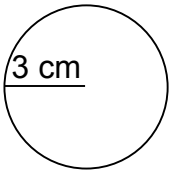

C=18.84 cm
A=28.26 cm²

2. 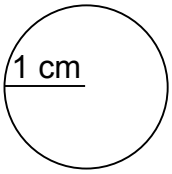

C=6.28 cm
A=3.14 cm²

3. 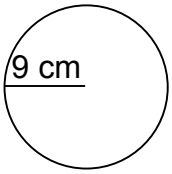

C=56.52 cm
A=254.34 cm²

4. 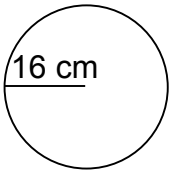

C=100.48 cm
A=803.84 cm²

5. 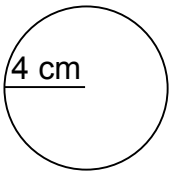

C=25.12 cm
A=50.24 cm²

6. 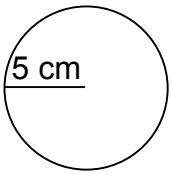

C=31.40 cm
A=78.50 cm²

7. 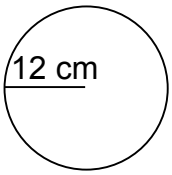

C=75.36 cm
A=452.16 cm²

8. 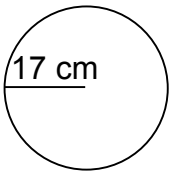

C=106.76 cm
A=907.46 cm²

9. 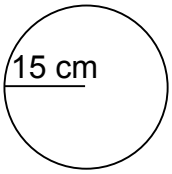

C=94.20 cm
A=706.50 cm²

10. 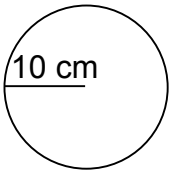

C=62.80 cm
A=314.00 cm²

11. 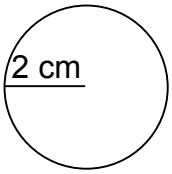

C=12.56 cm
A=12.56 cm²

12. 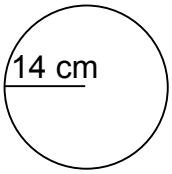

C=87.92 cm
A=615.44 cm²

13. 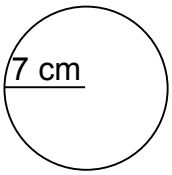

C=43.96 cm
A=153.86 cm²

14. 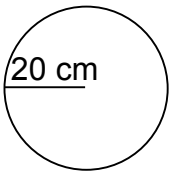

C=125.60 cm
A=1,256.00 cm²

15. 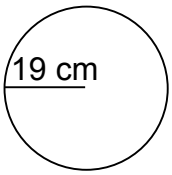

C=119.32 cm
A=1,133.54 cm²

16. 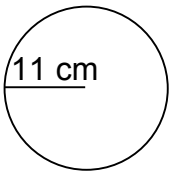

C=69.08 cm
A=379.94 cm²