Calculate the circumference of each circle.

1. 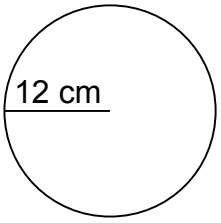

C=75.36 cm

2. 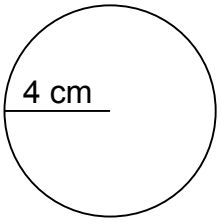

C=25.12 cm

3. 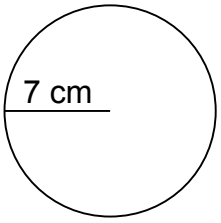

C=43.96 cm

4. 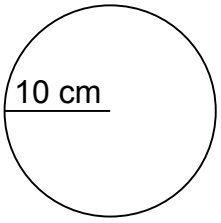

C=62.80 cm

5. 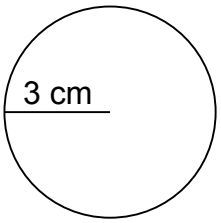

C=18.84 cm

6. 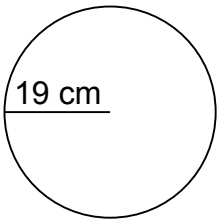

C=119.32 cm

7. 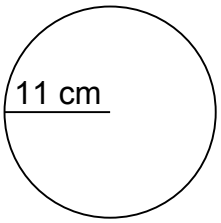

C=69.08 cm

8. 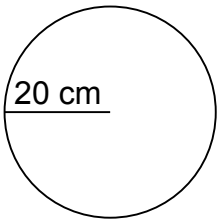

C=125.60 cm

9. 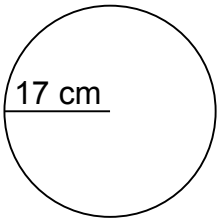

C=106.76 cm

10. 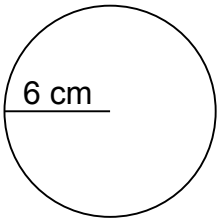

C=37.68 cm

11. 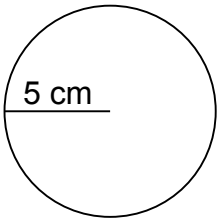

C=31.40 cm

12. 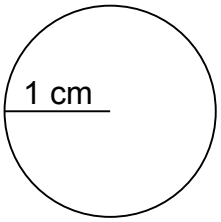

C=6.28 cm

13. 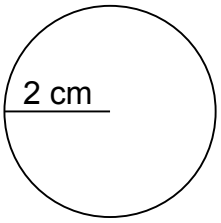

C=12.56 cm

14. 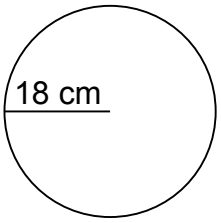

C=113.04 cm

15. 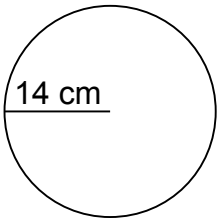

C=87.92 cm

16. 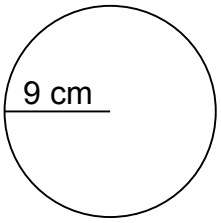

C=56.52 cm